Gr10Advanced **Math** **Mr. Abdulkader Amro**



Geometric Probability: Angle Measures and the Coordinate Plane

What is the probability of the spinner landing on yellow? Round your answer to 2 decimal places.

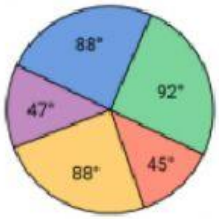

- ○ The probability is 0.49.
- ○ The probability is 4.09.
- ○ The probability is 0.24.
- ○ The probability is 0.88.

Abdulkader Amro

If a point is chosen at random in the coordinate grid, what is the probability that it will be inside the trapezoid or the parallelogram? Round your answer to 2 decimal places.

Drag and drop your answer to correctly complete the sentence.

The probability is _____.

0.28 0.26 0.16 0.22

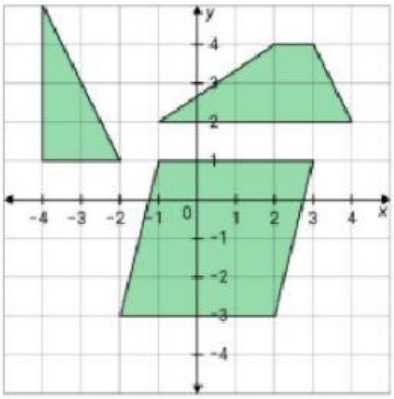

If a point is chosen at random in the coordinate grid, what is the probability that it will be inside the trapezoid or the parallelogram?

Round your answer to 2 decimal places.

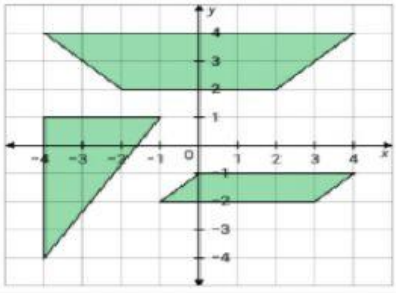

- ○ The probability is 0.24.
- ○ The probability is 0.16.
- ○ The probability is 0.28.
- ○ The probability is 0.84.

LIVEWORKSHEETS