Name:

## Mathematics

Write the time shown on the clocks below

It is __ o'clock.
__:00

It is __ o'clock.
__:00



It is __ o'clock.
__:00



It is __ o'clock.
__:00

It is __ o'clock.
__:00



It is __ o'clock.
__:00

It is __ o'clock.
__:00



It is __ o'clock.
__:00



It is __ o'clock.
__:00

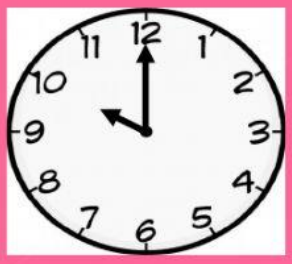

It is __ o'clock.
__:00

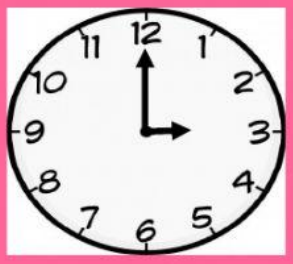

It is __ o'clock.
__:00

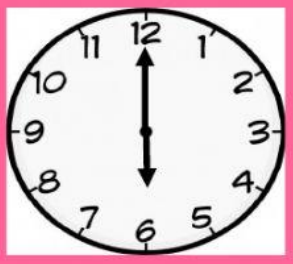

It is __ o'clock.
__:00

LIVEWORKSHEETS