Folha de trabalho

Nome: _____

I. Escreva por extenso as seguintes horas:

02:15

1. São as _____.

03:45

2. São as _____.

11:20

3. São as _____.

09:57

4. São as _____.

LIVEWORKSHEETS

II. Complete: que horas são? Exprese a sua resposta em um valor numérico. (Ex. 2:15).

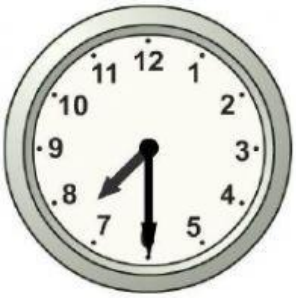

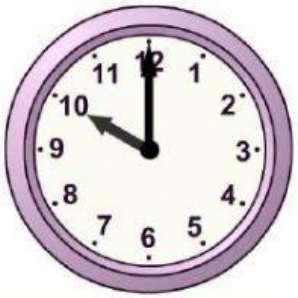



LIVEWORKSHEETS