Name:_____ Date:_____

Identify the quadrilaterals. Choose from: rectangle, parallelogram, rhombus, trapezoid, square, irregular quadrilateral

1.



_____

2.

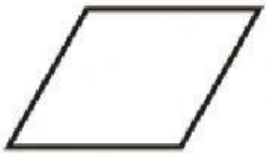

_____

3.

_____

4.

_____

5.

_____

6.

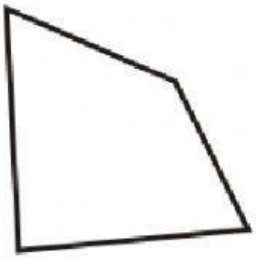

_____

7.

_____

8.

_____

9.

_____

LIVEWORKSHEETS