Escola Municipal Rodolf Mikel Ghannam	
Anápolis; _____ de _____ de 2021	
Professora (s):	
Estudante:_____	Ano/Turma: 8 º "__"

ATIVIDADE DE APRENDIZAGEM

1- Escreva a que máquina simples as imagens pertencem:

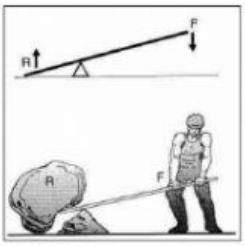

ALAVANCA

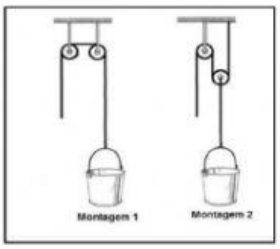

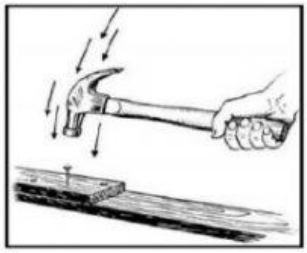

_____

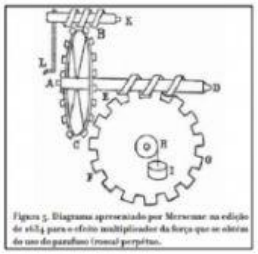

Figura 5. Diagrama apresentado por Moreaume na edição de 1874 para o efeito multiplicador da força que se obtém do uso do parafuso (roscal perpétuo).

LIVEWORKSHEETS