Mr. Young has 12 lollipops



a) He gives one third of them away. How many does he give away?

b) What fraction are red? (simplify your answer)

c) What fraction are not blue?

Mr. Young has 12 blue lollipops

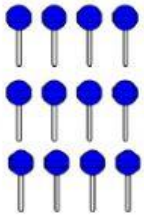

a) What fraction are green?

b) If he shares his lollipops with his friends, who gets the most?

David	Jenna	Hollie	Steve
$\frac{1}{2}$	$\frac{2}{3}$	$\frac{1}{6}$	$\frac{1}{3}$

Drag the fractions into the correct spot on the number line.

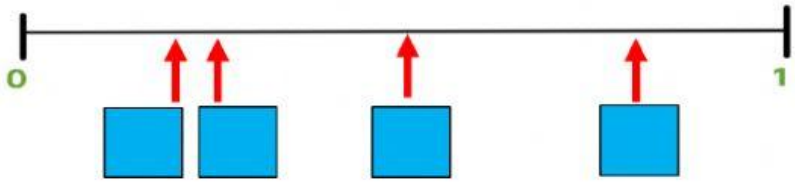

$\frac{1}{2}$ $\frac{1}{5}$ $\frac{4}{5}$ $\frac{1}{4}$

Match the triangle to its name

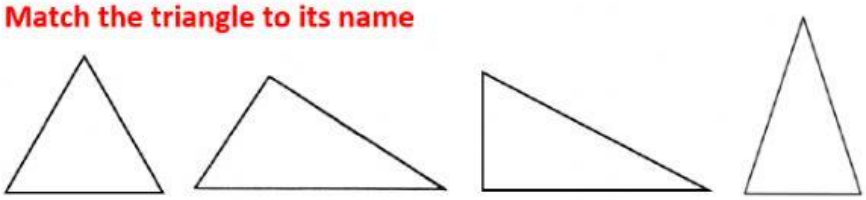

Scalene | Equilateral | Isosceles | Right Angle

LIVEWORKSHEETS

Mr. Young is putting a circle around all of the factors of 12, but he has forgot one. Tick the factor he has missed.

7 6 4 5 24 9 8 2 3 36 1 12

Mr. Young now has to circle the common factors of 16 and 32. It has been started. Tick the rest of the common factors.

2 3 12 16 1 4 5 8 6 10

Which of these number sentences is correct?

2 x 5 – 3 = 4
(2 x 5) – 3 = 4
2 x (5 – 3) = 4

Which of these number sentences is correct?

30 - (10 + 5) = 15
30 - 10 + 5 = 15
(30 - 10) + 5 = 15

Which graph shows the average height of pupils?

A

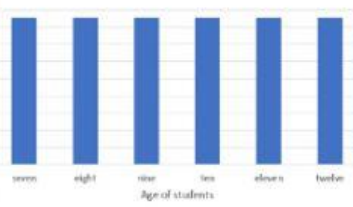

B

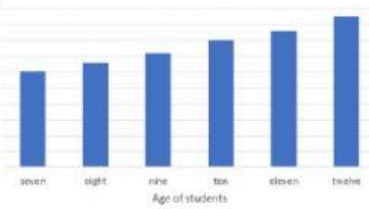

C

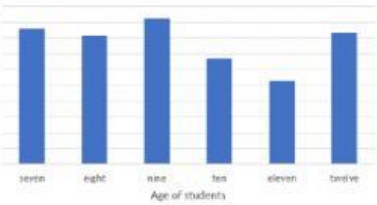

D

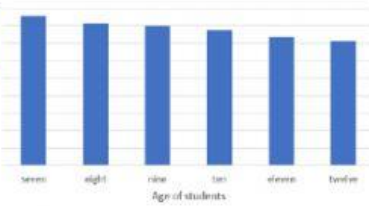

LIVEWORKSHEETS