MCQ-TEST1
VII Maths- Fractions

Name : _____ Class:_____

Write the suitable fractions for shaded and unshaded parts of the following figures.

1) 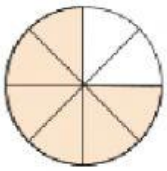

Shaded part = ---

2) 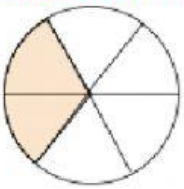

Shaded part = ----

3) 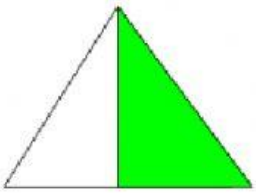

Shaded part = ---

4) 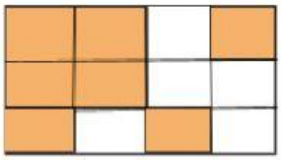

Shaded part = ---

5) 

Shaded part = ---

6) 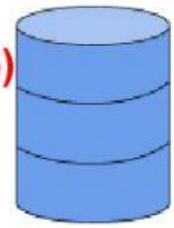

Shaded part = ---

7) 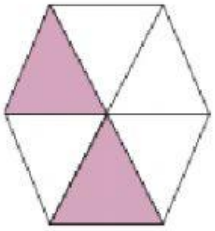

Shaded part = ---

8) 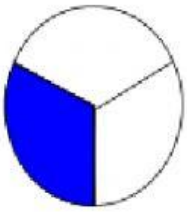

Shaded part = ---

9)

Shaded part = ---

10) 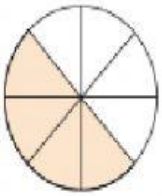

Shaded part = ---

LIVEWORKSHEETS