CUERPOS POLIEDROS REGULARES

EJERCICIO 1. Arrastra cada nombre hasta la figura correspondiente.

HEXAEDRO | ICOSAEDRO | OCTAEDRO | DODECAEDRO | TETRAEDRO

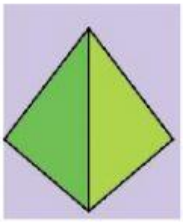
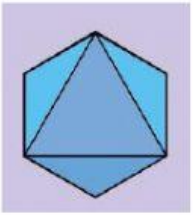
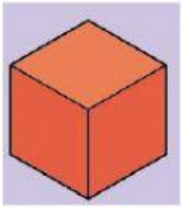

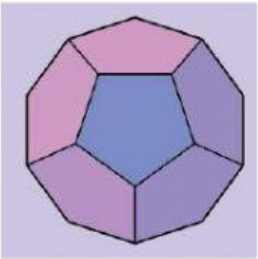

EJERCICIO 2. Completa las casillas con el valor correspondiente.

NOMBRE	VÉRTICES (V)	ARISTAS (A)	CARAS (C)
Tetraedro			
Cubo o hexaedro			
Octaedro			
Dodecaedro			
Icosaedro			

LIVEWORKSHEETS