Name:_____ Date:_____

Find the value of X for each figure. Each figure is in centimeters (cm). Not to scale.

1) Area = 6 cm^2

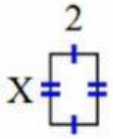

x = ☐

2) Area = 16 cm^2

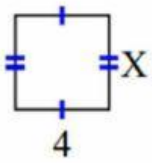

x = ☐

3) Area = 24 cm^2

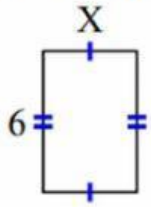

x = ☐

4) Area = 56 cm^2

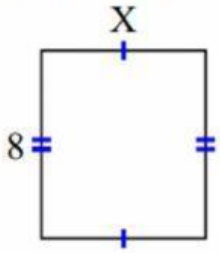

x = ☐

5) Area = 15 cm^2

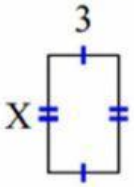

x = ☐

6) Area = 8 cm^2

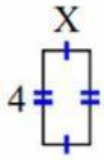

x = ☐

7) Area = 32 cm^2

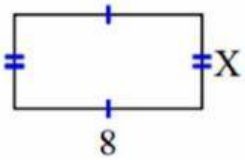

x = ☐

8) Area = 12 cm^2

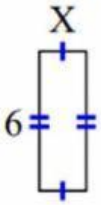

x = ☐

9) Area = 48 cm^2

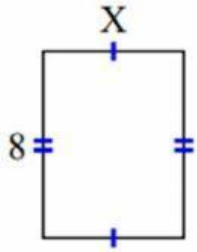

x = ☐

LIVEWORKSHEETS