EXERCISE 34

1.

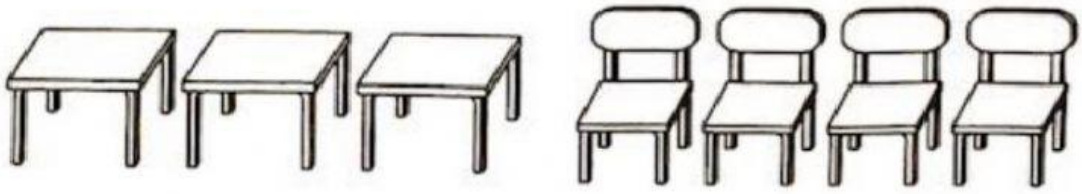

(a) The ratio of the number of tables to the number of chairs is

_____ : _____.

(b) The ratio of the number of chairs to the number of tables is

_____ : _____.

---

2. (a) The ratio of the number of triangles to the number of squares is

_____ : _____.

(b) The ratio of the number of squares to the number of triangles is

_____ : _____.

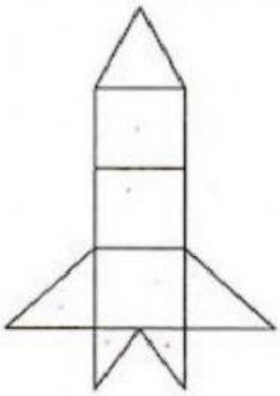

3.

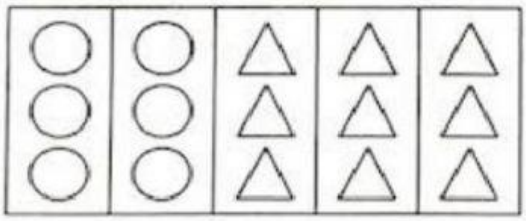

(a) The ratio of the number of circles to the number of triangles is

_____ : _____.

(b) The ratio of the number of triangles to the number of circles is

_____ : _____.

LIVEWORKSHEETS

4.

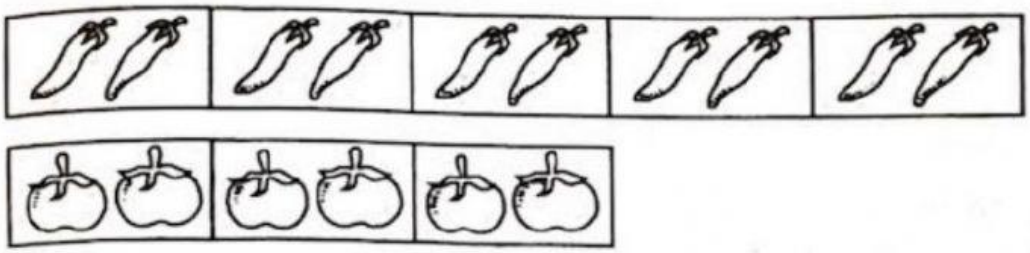

(a) The ratio of the number of peppers to the number of tomatoes is

_____ : _____.

(b) The ratio of the number of tomatoes to the number of peppers is

_____ : _____.

5.

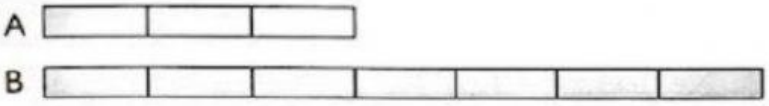

(a) The ratio of the length of Ribbon A to the length of Ribbon B is

_____ : _____.

(b) The ratio of the length of Ribbon B to the length of Ribbon A is

_____ : _____.

6.

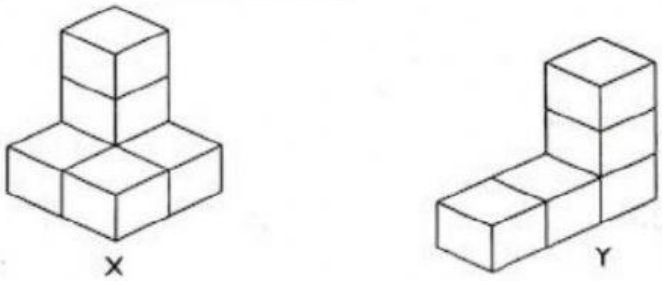

(a) The ratio of the volume of Solid X to the volume of Solid Y is

_____ : _____.

(b) The ratio of the volume of Solid Y to the volume of Solid X is

_____ : _____.

LIVEWORKSHEETS