Tentukan nama jenis sudutnya

13.

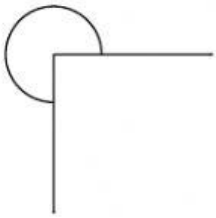

14.

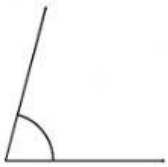

15.

16.

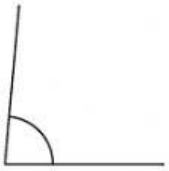

17.

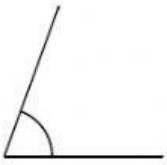

18.

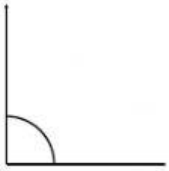

19.

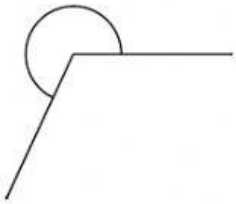

20.

21.

22.

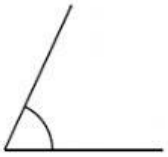

23.

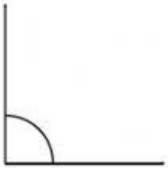

24.

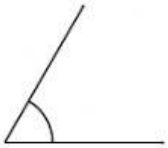

LIVEWORKSHEETS