Дараах биетүүдийн эзлэхүүнийг тооцоолоорой.

Нэгж кубын 1 ирмэг 1 см гэж үзнэ.

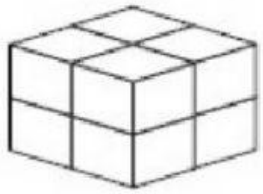

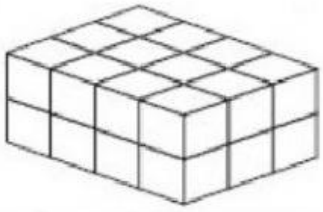

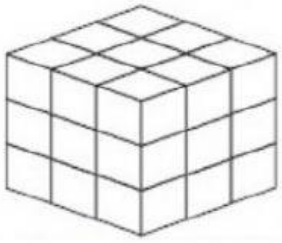

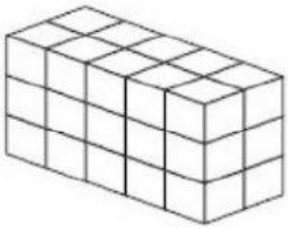

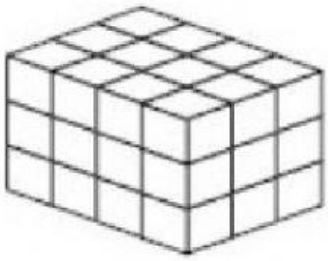

LIVEWORKSHEETS