Paralelograma pazīmes

Sasniedzamais rezultāts: *Lieto paralelograma (t. sk. romba, taisnstūra, kvadrāta) īpašības, lai aprēķinātu nezināmos lielumus, formulētu apgalvojumus par figūru īpašībām.*

1. Vai dotās figūras ir paralelogrami?





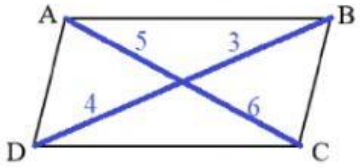

2. Dotās figūras ir paralelogrami, nosaki x.

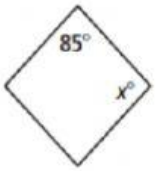

x= ° x= ° x= ° x= °

3. Dotās figūras ir paralelogrami, nosaki x un y .

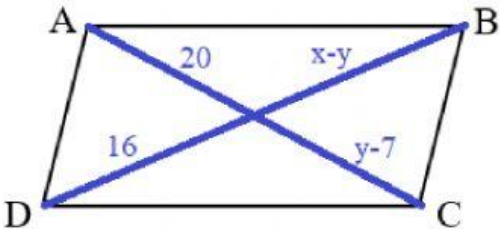

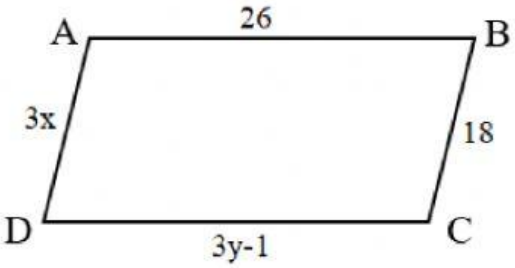

x= y= x= y=

4. Īsākā paralelograma mala ir 4,8cm, bet garākā mala ir uz pusi garāka kā īsākā mala. Nosaki paralelograma perimetru.

cm

Vai šāda veida interaktīvās darba lapas veicina interesi par matemātikas mācīšanos?

LIVEWORKSHEETS