Find the perimeter and area of the figure.

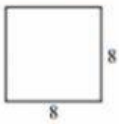

Area = inches^2

Perimeter = inches

1

Find the perimeter and area of the figure.

Area = inches^2

Perimeter = inches

2

Find the perimeter and area of the figure.

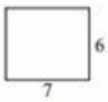

Area = inches^2

Perimeter = inches

3

Find the perimeter and area of the figure.

Area = inches^2

Perimeter = inches

4

Find the perimeter and area of the figure.



Area = inches^2

Perimeter = inches

5

Find the perimeter and area of the figure.

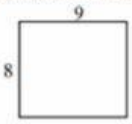

Area = inches^2

Perimeter = inches

6

Find the perimeter and area of the figure.

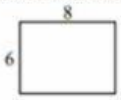

Area = inches^2

Perimeter = inches

7

Find the perimeter and area of the figure.

Area = inches^2

Perimeter = inches

8

LIVEWORKSHEETS