ΧΙΟΝΟΝΙΦΑΔΕΣ & ΑΡΙΘΜΟΙ

Μέτρησε τις χιονονιφάδες στην κάθε σειρά και αντιστοίχισέ τες στον σωστό αριθμό

4



3



1

5



2

Α.Γ.02/02/2021