Unit of capacity

Name…….. Date……..

1 Litre= 1000 ml

1. How much water is in this measuring jug?

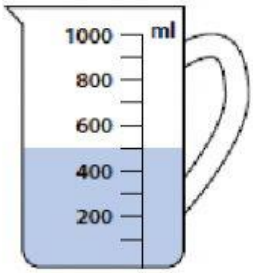

2. A jug holds 2 litres of juice.

How many 150 ml cups of juice can be filled from the jug? How much in Mili litter in the jug?

3. Which jug contains more water, A or B?

How much more does it contain? Explain how you worked it out.

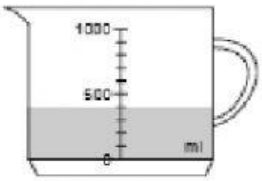

A

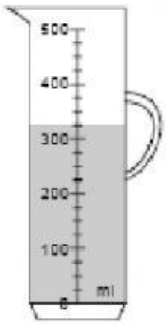

B

Shaheda Azam

Unit of capacity

Name…….. Date……..

4. Sophie poured some water out of a litre jug.
Look how much is left in the jug. Estimate how much water is left.

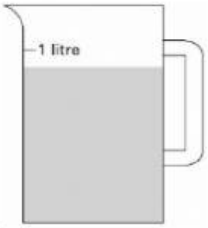

5. If a can of cola holds 100ml, how much will 4 cans hold?

6. A bath holds 80 litres. A shower uses 35 litres. How many litres are used if Mrs Hitchins has a bath and Ms Wreghitt has a shower?

6. B How much water will we save if Mrs Hitchins decides to have a shower too?

Shaheda Azam

Unit of capacity

Name…….. Date……..

Shaheda Azam