Name:_____ Date: _____

Mathematics- Computation

Tens

Count by tens. Click the number.

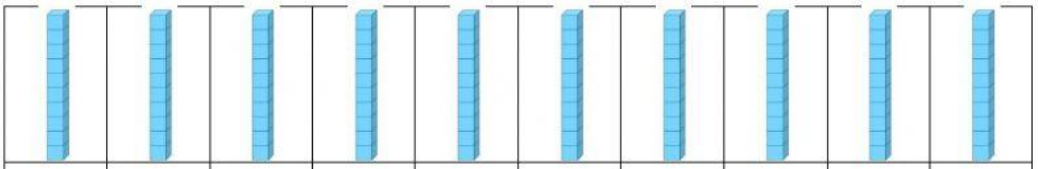

10	20	30	40	50	60	70	80	90	100

1. 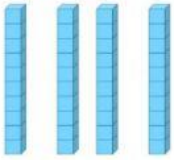 20 30 40

2. 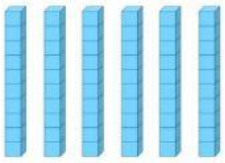 60 70 80

3. 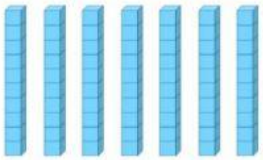 50 60 70

4. 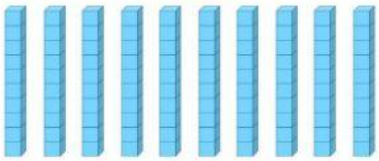 80 90 100

5. 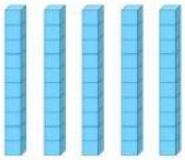 40 50 60