NAME:_____ DATE:_____

"QUADRILATERAL"

Direction: Write the types of each quadrilateral.

1)

_____

2)

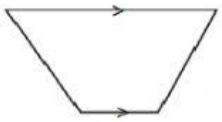

_____

3)

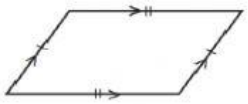

_____

4)

_____

5)

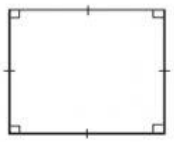

_____

6)

_____

7)

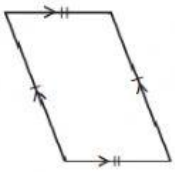

_____

8)

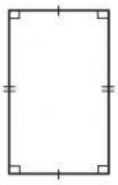

_____

9)

_____

10)

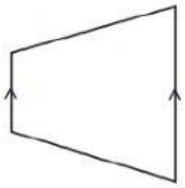

_____

11)

_____

12)

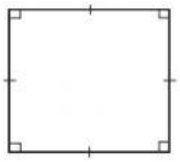

_____