Worksheet 3

Comparing and Ordering Numbers

1 Write the numbers in the tables. Then fill in the blanks.

(a) Compare 98 325 and 89 946.

Ten Thousands	Thousands	Hundreds	Tens	Ones

_____ is greater than _____.

_____ > _____

(b) Compare 106 870 and 106 241.

Hundred Thousands	Ten Thousands	Thousands	Hundreds	Tens	Ones

_____ is smaller than _____.

_____ > _____

2 Use **>** or **<** to make the statements correct.

(a) 97 423 ◯ 67 324

(b) 11 500 ◯ 12 501

(c) 56 868 ◯ 56 688

(d) 297 568 ◯ 503 243

(e) 264 834 ◯ 265 834

(f) 304 306 ◯ 304 256

(g) 215 400 ◯ 15 800

(h) 86 109 ◯ 840 169

3 Write the numbers in the tables. Then fill in the blanks.

(a) Order 12 050, 15 200, 10 500 from smallest to largest.

Ten Thousands	Thousands	Hundreds	Tens	Ones

_____, _____, _____
smallest

(b) Order 573 485, 574 358, 485 735 from largest to smallest.

Hundred Thousands	Ten Thousands	Thousands	Hundreds	Tens	Ones

_____, _____, _____
largest

4 (a) Order 68 461, 86 146 and 64 168 from smallest to largest.

_____, _____, _____
smallest

(b) Order 483 465, 434 856 and 468 435 from largest to smallest.

_____, _____, _____
largest

5 Order the numbers.

(a) 24 310 42 013 34 021

_____ < _____ < _____

(b) 37 650 36 700 47 600

_____ < _____ < _____

(c) 120 405 124 005 100 245

_____ < _____ < _____

(d) 11 011 100 101 11 100

_____ > _____ > _____

(e) 30 571 275 017 57 312

_____ > _____ > _____

(f) 79 321 723 190 703 910

_____ > _____ > _____

6 Form 6-digit numbers using the number cards shown.
Use each digit only once in each number.



(a) The largest possible odd number

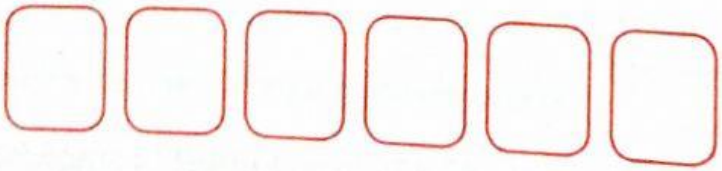

(b) The smallest possible even number