Directions: Click the correct box to name the shape.

△○□ Name That Shape! □○△

Circle the correct answer.

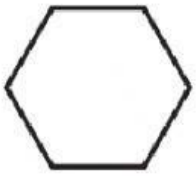 a. pentagon b. hexagon c. octagon	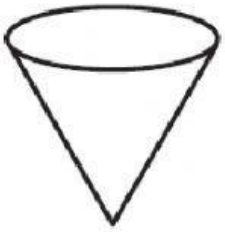 a. cone b. pyramid c. triangle
a. rectangle b. square c. cube	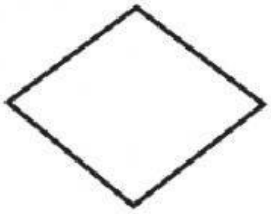 a. rectangle b. square c. diamond
a. diamond b. rhomboid c. rectangle	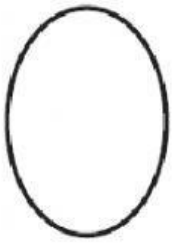 a. circle b. oval c. sphere
a. cylinder b. prism c. oval	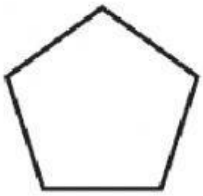 a. octagon b. hexagon c. pentagon
a. oval b. sphere c. circle	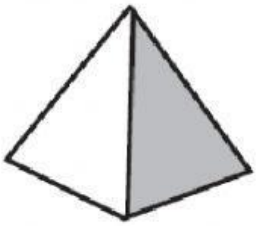 a. prism b. pyramid c. cone