Write the number of faces, edges, and vertices

Name: _____

3D Solid Detective

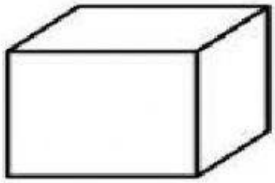

Faces: _____
Edges: _____
Vertices: _____

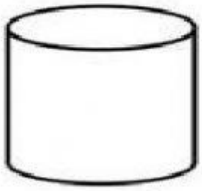

Faces: _____
Edges: _____
Vertices: _____

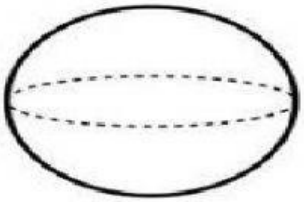

Faces: _____
Edges: _____
Vertices: _____

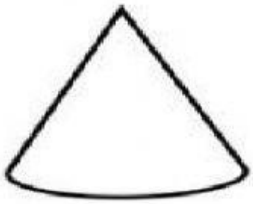

Faces: _____
Edges: _____
Vertices: _____

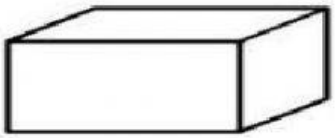

Faces: _____
Edges: _____
Vertices: _____

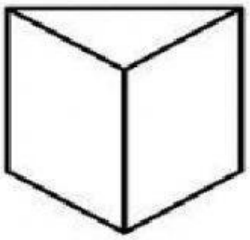

Faces: _____
Edges: _____
Vertices: _____