10 and Some More - Numbers 10 - 19

Enter how many more in the box.	Number
 10 and _____ more.	
 10 and _____ more.	
 10 and _____ more.	
 10 and _____ more.	
 10 and _____ more.	

Huda has 10 dolls in her room. She also has 8 teddy bears. How many toys does she have altogether?	10 and ___ more, equals _____.
Mansour has 10 red cars. He also has 2 green cars. How many cars does he have in all?	10 and ___ more, equals _____.
Latifa has 10 yellow balloons. She also has 7 blue balloons. How many balloons does she have in total?	10 and ___ more, equals _____.
Mohammed eats 10 ice-creams. Zayed eats 4 more. How many ice-creams do they eat altogether?	10 and ___ more, equals _____.
Lina has 10 yellow stickers. Mariam has 6 stickers. How many stickers do they have in total?	10 and ___ more, equals _____.
Afraa has 10 cookies. Reem has 3 cookies. How many cookies are there in all?	10 and ___ more, equals _____.
Saleh has 10 chocolates. Nahyan has 9 chocolates. How many chocolates are there altogether?	10 and ___ more, equals _____.