Name: _____ P1

First Term Exams: Maths

Part 1: Zero

Write a number in each blank space so that the sum is right.

1) 6 – 0 = _____ 2) 8 + 0 =_____

3) 9 – 9 = _____ 4) 5 – _____= 0

5) ____ + 3 =3 6) ____ - 7 = 0

(6 Marks)

Part 2: Addition and Subtraction

Solve the following questions:

1) 7+2= 2) 9-6=

3) 5-4= 4) 8+3=

5) 6+3= 6) 8-3=

7) 7-4= 8) 9-5=

9) 1+3+6= 10) 5+2+3=

(10 Marks)

Part 3: Place Value

Write the following numbers as figures (not words). The first one is done for you.

Example: Two tens and five ones: 25

1. One ten and one one: _____
2. Four tens and two ones: _____
3. Two tens and nine ones: _____
4. Six tens and three ones: _____
5. Nine tens and nine ones: _____

(5 marks)

Part 4: Comparing Lengths

Write the numbers 1, 2, and 3 in the box next to each object to oder the objects in each row from **shortest** to **longest**.

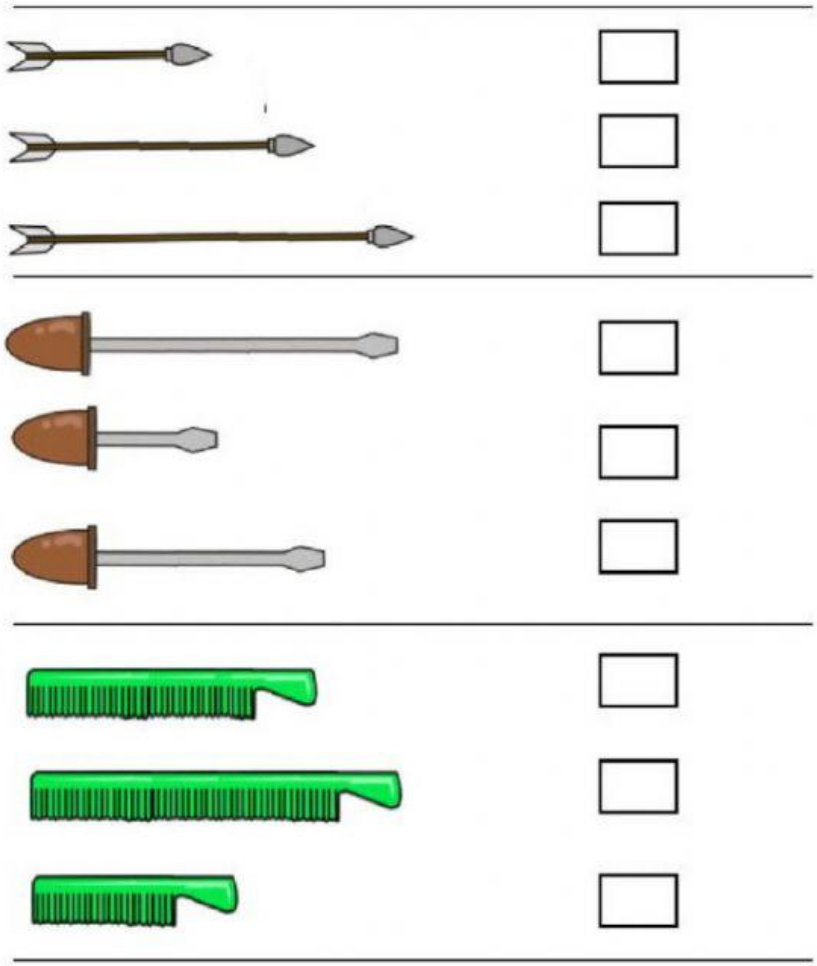

(3 Marks)

Part 5: 3D Shapes

5a: 2D and 3D shapes

Draw a line to match the 2d shape to the correct 3d shape.

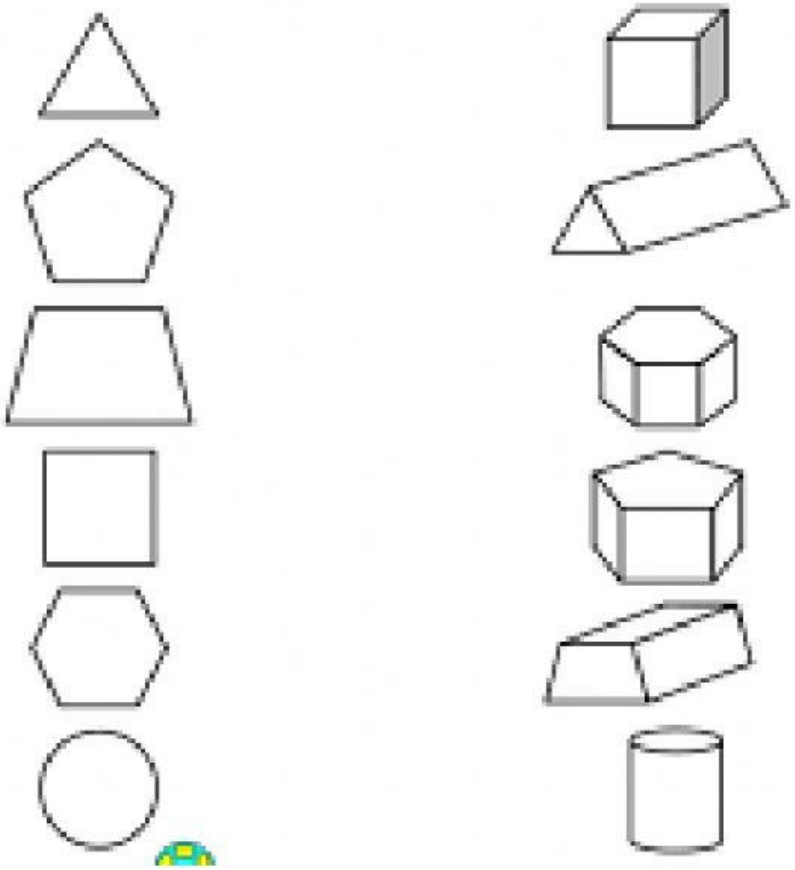

(6 marks)

5b Names of 3D shapes

Circle the correct words.

 cone / cylinder	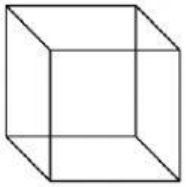 cube / pyramid
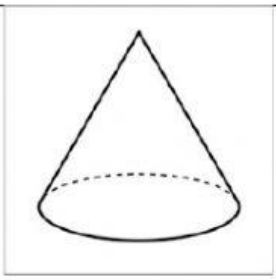 cone / pyramid	 pyramid / prism
 cylinder / sphere	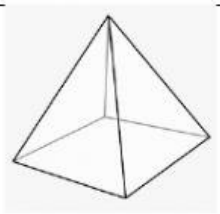 pyramid / prism

(6 Marks)