Last Name: _____	First name: _____	Date: _____	Class Period

Graphs

EXERCISES ***Solve. Use the picture graph.***

1. How many people went to the playground in July?
2. In what month was attendance the least?
3. In what months did more than 400 people attend?

Summer Attendance at the Playground



Solve. Use the line graph.

4. How many people were in the bicycle club in April?
5. How many members were in the club in October?
6. When did the membership go over 20?

Bicycle Club Memberships

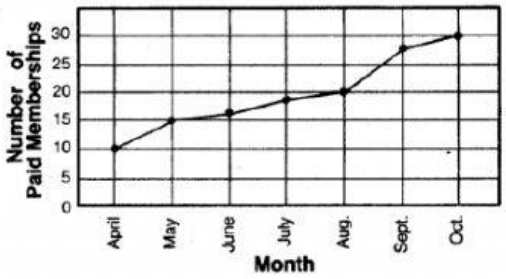

Use the information from the chart to determine how much must be added for shipping and handling.

7. $18
8. $9.50
9. $27.33
10. $25
11. $62.75
12. $12.18

PLEASE INCLUDE FOR SHIPPING AND HANDLING	
Orders up to $10.00	add $1.95
Orders from $10.01 to $15.00	add $2.95
Orders from $15.01 to $25.00	add $3.65
Orders from $25.01 ot $35.00	add $3.95
Orders from $35.01 to $50.00	add $4.65
Orders over $50.00	add $4.95

This bar chart below shows insects found in a garden. Study the graph carefully and fill in each blank with the correct answer.

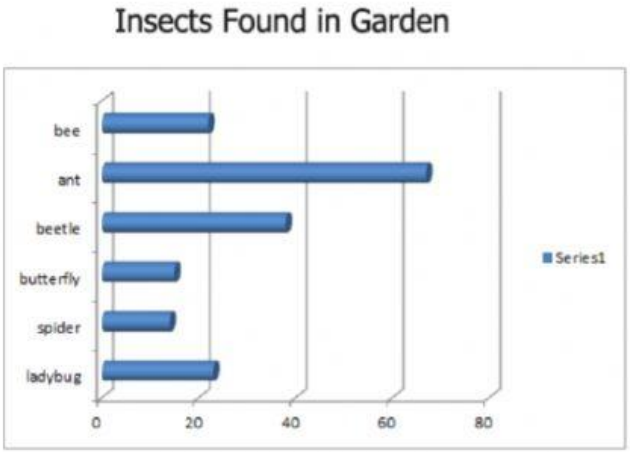

1. **There are more _____ than any other insects found in the garden.**
2. **The title of this chart is _____**
3. **There are more _____ than beetles in the garden.**
4. **There are fewer _____ than butterflies.**
5. **There are total _____ different types of insects are shown.**
6. **List the insects from the fewest to the largest nubmer found in the garden.**

   _____ _____ _____ _____ _____ _____