# Adunarea cu 3 unitati

1.Folosind axa numerelor efectuează operațiile date:

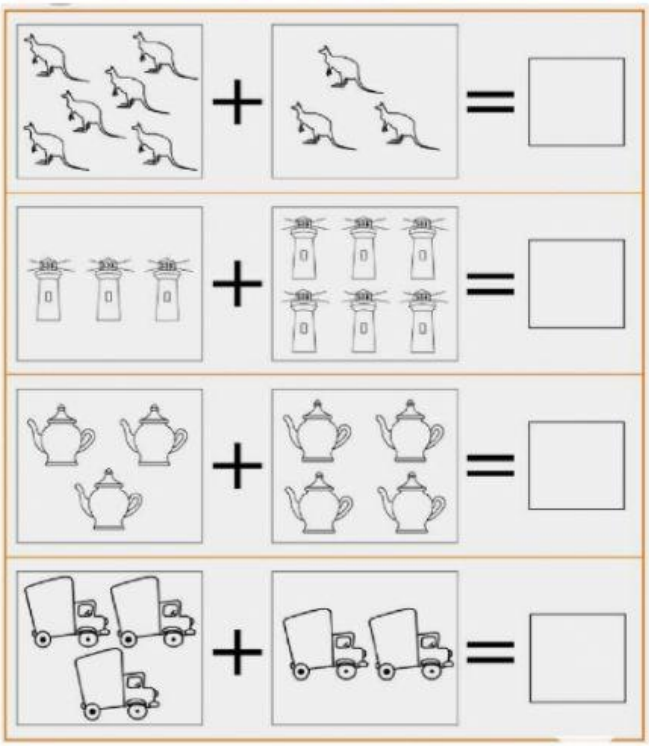

| | |
|---|---|
| 3 + 0 = ___ | 0 + 3 = ___ |
| 3 + 1 = ___ | 1 + 3 = ___ |
| 3 + 2 = ___ | 2 + 3 = ___ |
| 3 + 3 = ___ | 3 + 3 = ___ |
| 3 + 4 = ___ | 4 + 3 = ___ |
| 3 + 5 = ___ | 5 + 3 = ___ |
| 3 + 6 = ___ | 6 + 3 = ___ |
| 3 + 7 = ___ | 7 + 3 = ___ |

2.Câte mere au fost la început pe fiecare pom? Scrie calculul .

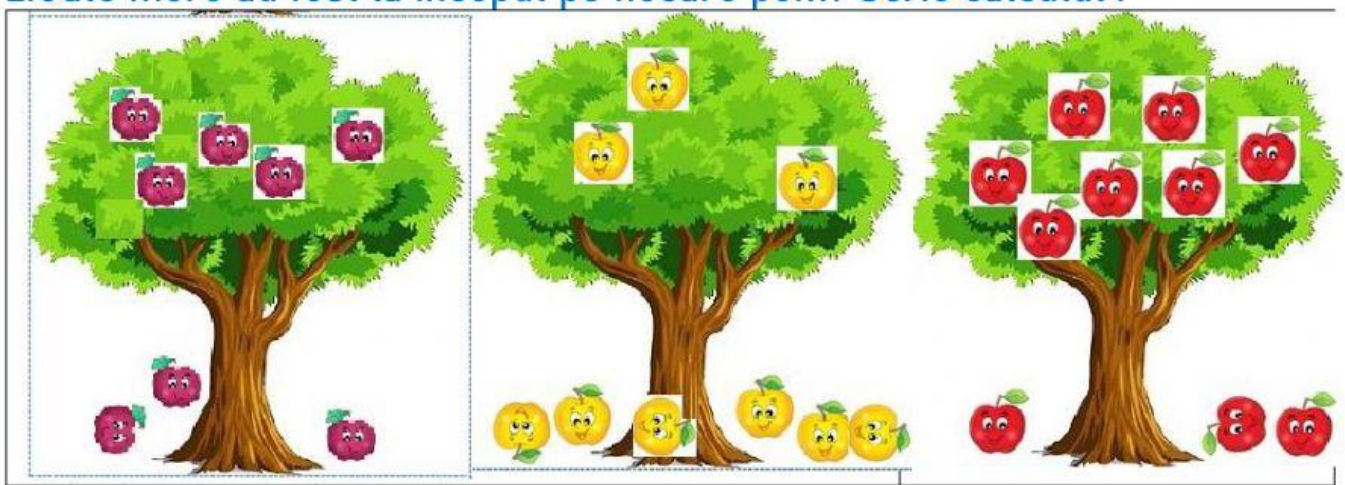

| | | |
|---|---|---|
| | | |

3.Completează schemele cu numerele potrivite:

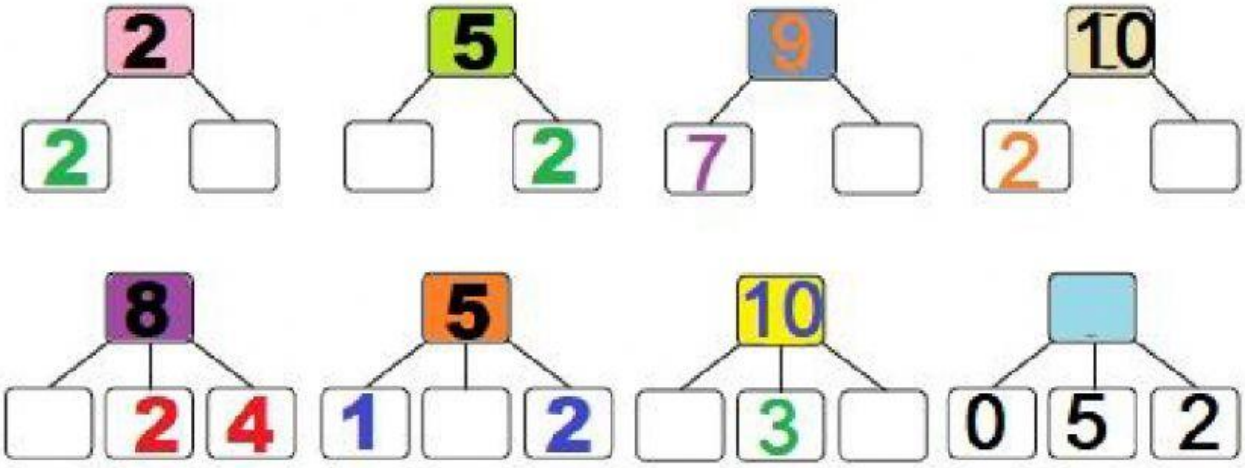


4.Scrie operația de adunare a fluturașilor folosindu-te de culorile lor pentru a afla câți fluturași se bucură de soare pe câmp.



**Felicitări! Ai ajuns la final!**