Comparing fractions visually

Instructions:

First, write the value of the two fractions you see in each question. Then, in the box below, say which fraction is the greatest.

1

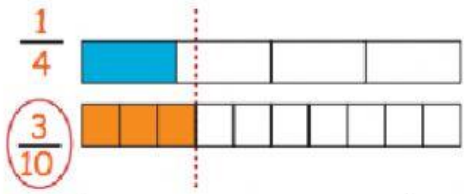

3/10 is greater than 1/4

2

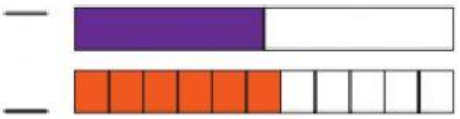

3



4

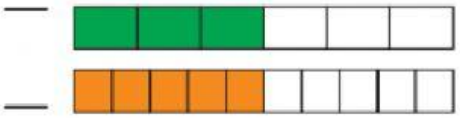

5



6



7

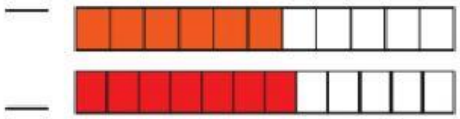

8



9

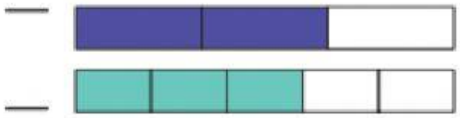

10

