Starter - Circle

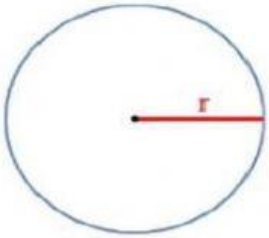

1. If the Radius of a circle is 12 cm. What is diameter of the circle?

a. 15 cm
b. 12 cm
c. 23 cm
d. 24 cm
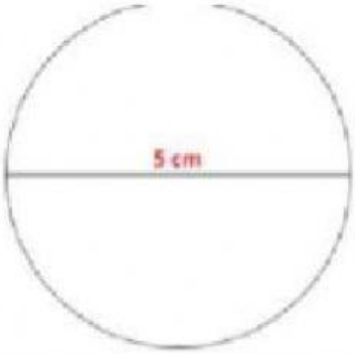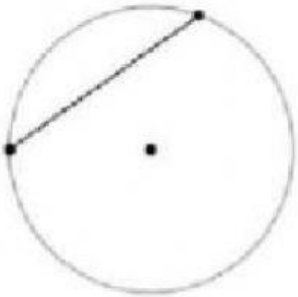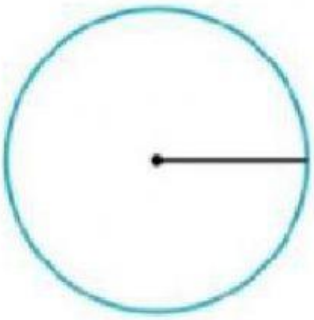
Identify the parts of circle