Aşağıdaki varlıklardan büyük olanı işaretleyin.





Aşağıdaki varlıklardan küçük olanı işaretleyin.

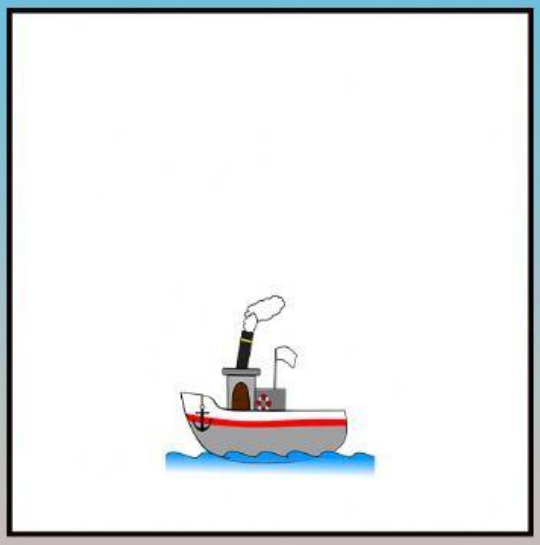

EĞİTİME DESTEK

Evdekiokul