Child Evaluation Kg-3 2021

19th January 2021

Write the missing numbers:



2 5 3

6 9 7

10 13 11

15 14
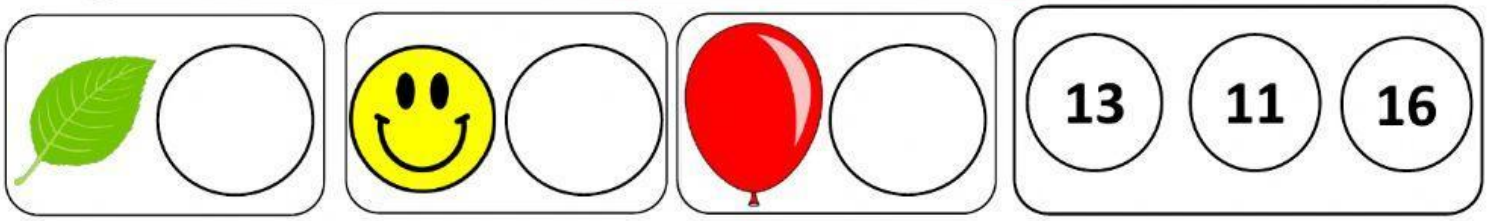
Count and write the number