PENYELENGGARA PENDIDIKAN YAYASAN SALIB SUCI
SD YOS SUDARSO SUBANG
Jl. Ahmad Yani No. 31 Subang 0260-411434

Senin, 18 Januari 2021

Matematika KD 3.2

(Membilang dari 21-40)

A. Hitunglah jumlah balok di bawah ini !

1. 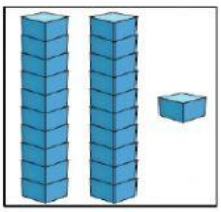

2. 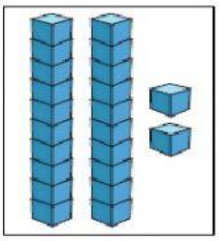

3. 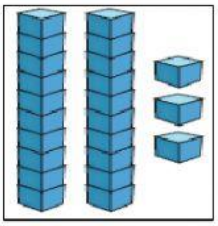

4. 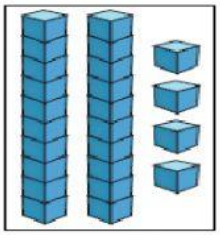

5. 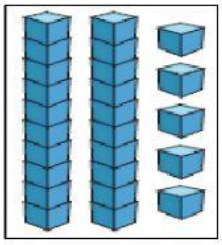

6. 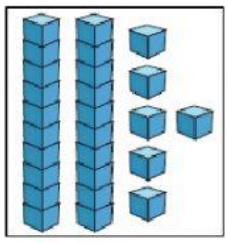

7. 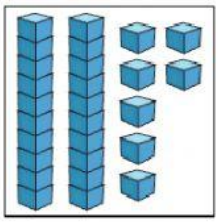

8. 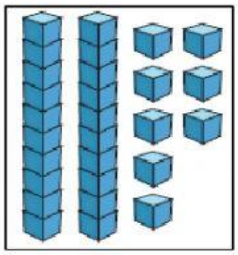

9. 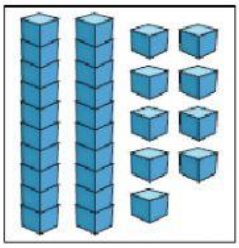

10. 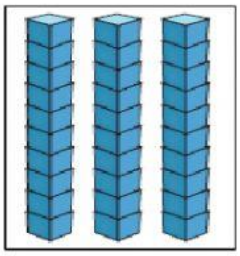

11. 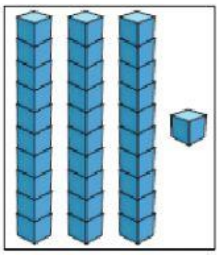

12. 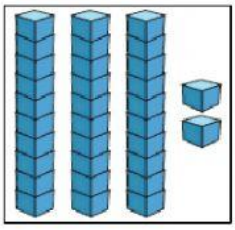

13. 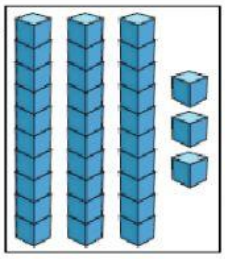

14. 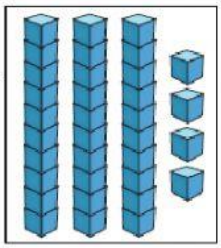

15. 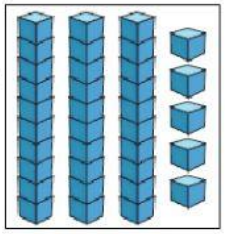

16. 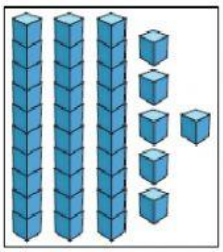

17. 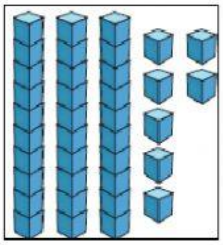

18. 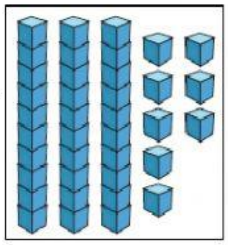

19. 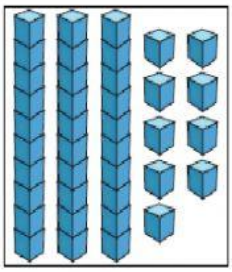

20. 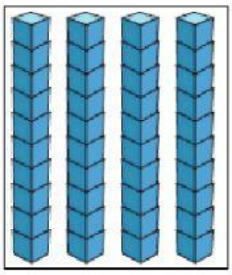

B. Lengkapilah tabel bilangan di bawah ini !

	22		24
25			28
		31	
		35	
	38	39	

23	26	21	27
33	34	29	32
36	40	37	30