Days of the Week

Which day comes next?

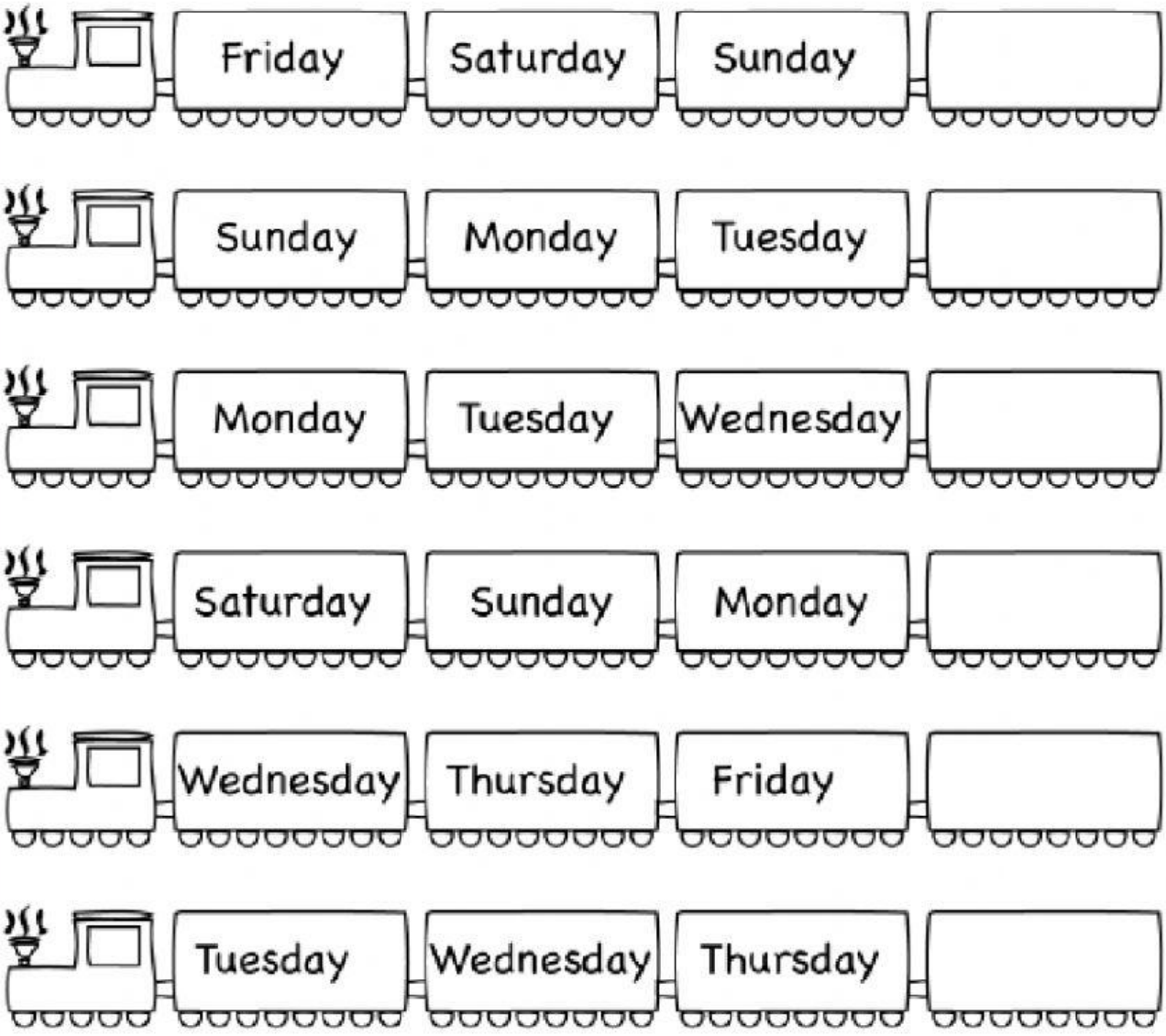

Months of the Year

Which month comes next?



Telling Time 2



Melissa Mouse is learning how to read a clock.
Help her finish writing the times for each clock by looking at each clock and writing the time you see.



__:00



__:00

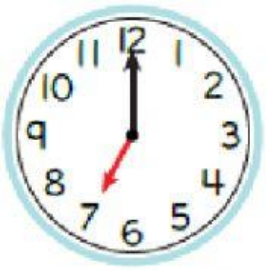

__:00



__:00

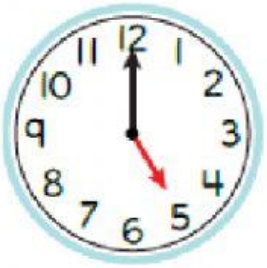

__:00



__:00



Select the clock showing Time: 2 o'clock (2:00)

Complete the picture of the clock by writing the missing numbers on its dial



Write the time when you wake up in the morning. ☐ a.m.

Write the time when you go to sleep in the morning. ☐ p.m.

Click on finish ➡ Check my Answer and see your result.