Mathematics

Concepts GCW

How many tens and ones?

A.

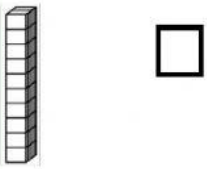

____tens _____ones=_____

B.

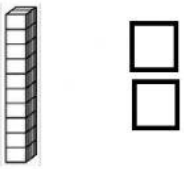

____tens _____ones=_____

C.

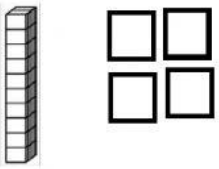

____tens _____ones=_____

D.

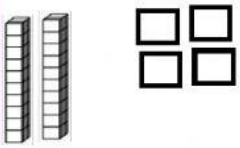

____tens _____ones = ____

E.

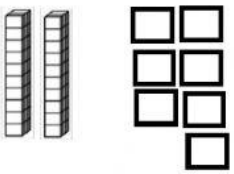

____tens _____ones = ____

F.

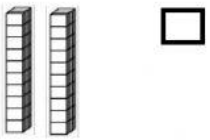

____tens _____ones = ___

G.

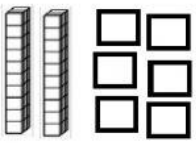

Tens	Ones

= _____

H.

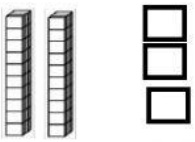

Tens	Ones

= _____

Instructions: Fill in the missing numbers.

I. 36, _____, _____, 39

J. 31, _____, 33, _____, 35

K. 36, _____, 38, _____

L. 30, _____, 32, _____, _____, 35, _____, 37, _____, 39