1. Potriveşte cifra corespunzătoare fiecărei grupe de obiecte:

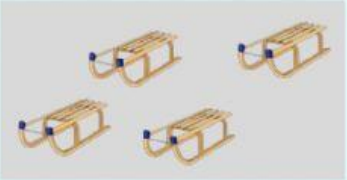

1 2 3 4

2. Găseşte perechea!

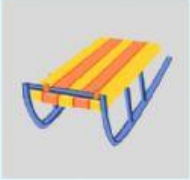

3. Selectează grupa cu cele mai multe obiecte:

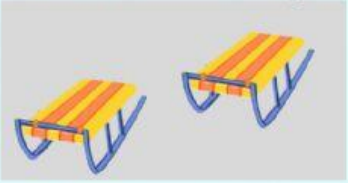

4. Selectează grupa cu cele mai puţine obiecte: