IDENTIFICA LAS SIGUIENTES DISPLASIAS PILOSAS CONGÉNITAS:

1.

2.

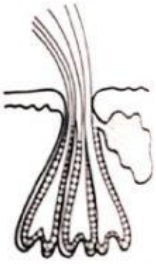

3

4

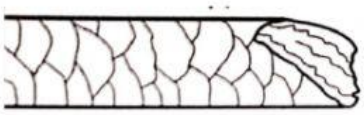

5

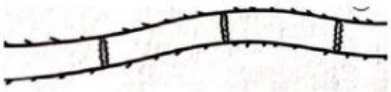

6

7

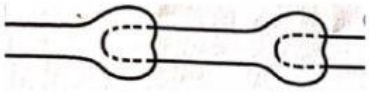

IDENTIFICA LAS SIGUIENTES DISPLASIAS PILOSAS ADQUIRIDAS:

A

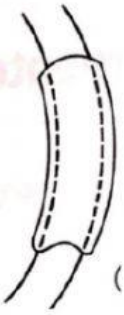

B

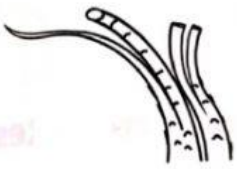

C

D