Year 4 Maths **Term 2 Week 2 Lesson 3**

LO: Recognise and understand simple fractions

Please click on the live link and type the answers.

What fraction of each shape is grey?

(1)

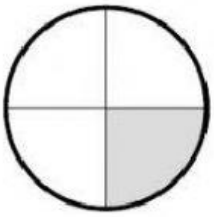

= $\frac{1}{4}$

(2)

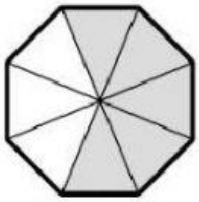

= $\frac{\square}{\square}$

(3)



= $\frac{\square}{\square}$

(4)



= $\frac{\square}{\square}$

(5)

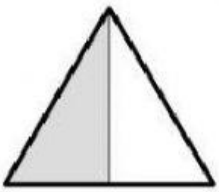

= $\frac{\square}{\square}$

(6)

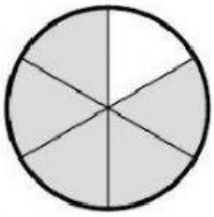

= $\frac{\square}{\square}$

(7)



= $\frac{\square}{\square}$

(8)

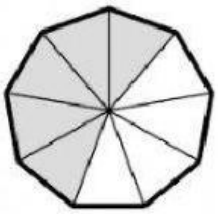

= $\frac{\square}{\square}$

(9)

= $\frac{\square}{\square}$

(10)



= $\frac{\square}{\square}$

(11) What fraction of the puzzle pieces are **green**?

_____

(12) What fraction of the animals are **cats**?

_____

(13) What fraction of the animals are **zebras**?

_____

(14) What fraction of the flowers are **yellow**?

_____

(15) What fraction of the flowers are **pink**?

_____

(16) What fraction of shirts is **not black**?

_____