SD Darul Hikam
Berakhlak Berprestasi

LKS MATEMATIKA KELAS III

MENGKONVERSI JAM DAN MENIT

بِسْمِ اللَّهِ الرَّحْمَٰنِ الرَّحِيمِ

NAMA SISWA:

Tuliskan waktu dalam satuan menit!

1) 1 jam 40 menit =_____menit
2) 2 jam 25 menit =_____menit
3) 5 jam 50 menit = _____menit

1 jam = 60 menit
2j am = 120 menit
3 jam= 180 menit
4 jam = 240 menit
5 jam = 300 menit
6 jam = 360 menit

Tuliskan waktu dalam satuan jam!

1) 180 menit = ____ jam
2) 360 menit = ____ jam
3) 240 menit = ____ jam

Tuliskan waktu dalam satuan jam dan menit!

Contoh: 190 menit = 3 jam 10 menit

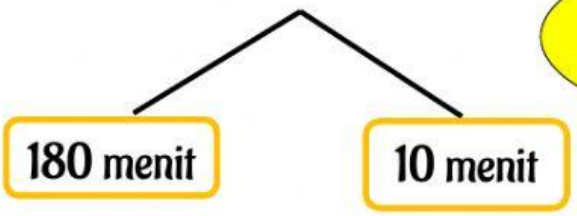

180 menit = 3 jam

190 menit - 180 menit= 10 menit

196 menit = ___ jam ___ menit

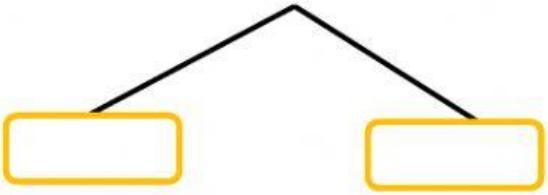

255 menit = ___ jam___ menit

315 menit = ___ jam ___ menit

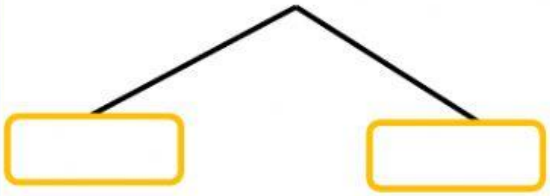

295 menit = ___ jam___ menit

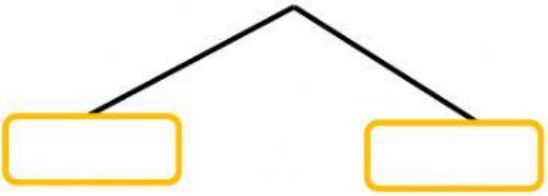

أَلْحَمْدُ لِلّٰهِ رَبِّ الْعٰلَمِيْنَ