Introduction to Integers

Name: _____ Class: _____

Complete the following:

1. The red dot lies on _____

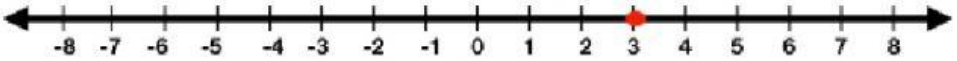

2. Choose the letter that shows +7 _____

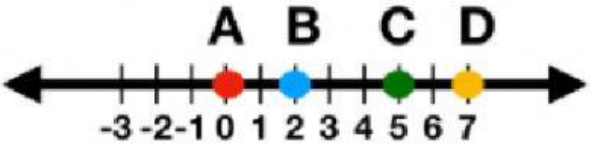

3. Which of the letters on the number line represent negative integers?

_____

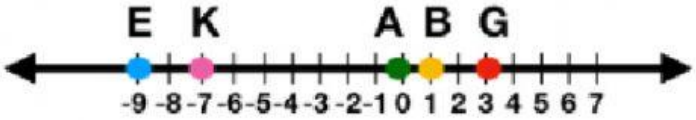

4. The letter _____ represent -5.

5. The letter _____ represent 0.

Teachers code: btk0gq1888