4 Geometria

Begiratu arretaz, pentsatu eta erantzun.

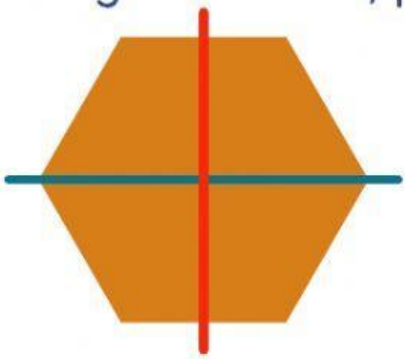

- Lerro gorria simetria ardatz bat da? ☐
- Eta lerro berdea? ☐
- Egin dezakegu beste simetria-ardatz bat? ☐
- Izan dezake irudi batek simetria-ardatz bat baino gehiago? ☐
- Gerta daiteke irudi batek simetria-ardatzik ez izatea? ☐

Begiratu arretaz irudiak eta lotu.

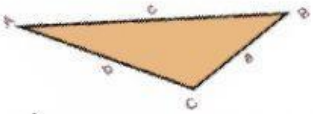

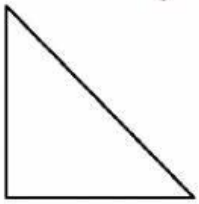

triangelu isozelea

triangelu aldeberdina

triangelu eskalenoa

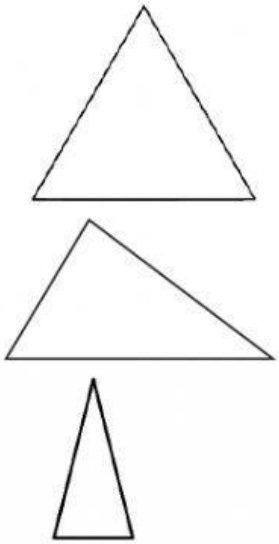

Kalkulatu irudi hauen perimetroa:

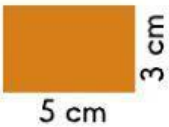

☐ + ☐ + ☐ + ☐ = ☐ cm

☐ + ☐ + ☐ = ☐ cm