Η προπαίδεια του 10

1. Συμπληρώνω την προπαίδεια του 10:



1 x 10 = ...

2 x 10 = ...

... x 10 = 30

4 x 10 = ...

... x 10 = 50

6 x 10 = ...

7 x 10 = ...

.... x 10 = 80

9 x 10 = ...

10 x 10 = ...

2. Γράφω την προπαίδεια που ταιριάζει σε κάθε εικόνα.
Δεν ξεχνώ να γράφω πρώτα τις φορές.

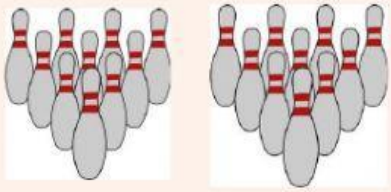

... x ... = ...

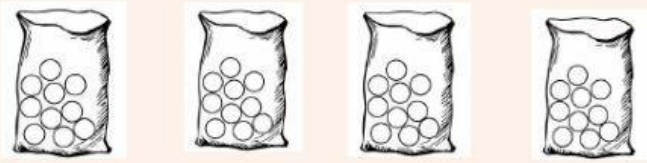

... x ... = ...



... x ... = ...

... x ... = ...

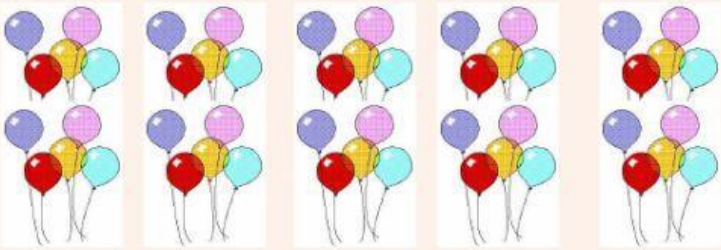

... x ... = ...

Επιμέλεια: Δέσποινα Μπακαρή

3. Ανεβαίνω 10…10 και κατεβαίνω 10...10:

Ανεβαίνω:	10				50					
Κατεβαίνω:	100							30		

4. Αντιστοιχίζω σωστά:

3 x 10	50
7 x 10	20
1 x 10	40
0 x 10	80
6 x 10	30
4 x 10	0
5 x 10	100
2 x 10	10
8 x10	70
10 x 10	90
9 x 10	60



Επιμέλεια: Δέσποινα Μπακαρή