DENK KESİRLER

Aşağıdaki kesirleri modeller yardımıyla genişleterek ya da sadeleştirerek bu kesirlere denk kesirler oluştur.

1 a.

$\frac{6}{10} = \frac{\square}{\square}$

1 b.

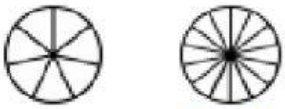

$\frac{4}{7} = \frac{\square}{\square}$

2 a.

$\frac{6}{9} = \frac{\square}{\square}$

2 b.

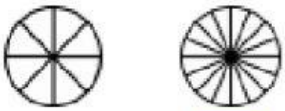

$\frac{5}{8} = \frac{\square}{\square}$

3 a.

$\frac{5}{5} = \frac{\square}{\square}$

3 b.

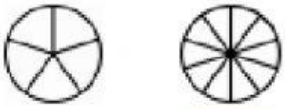

$\frac{5}{5} = \frac{\square}{\square}$

4 a.

$\frac{2}{10} = \frac{\square}{\square}$

4 b.

$\frac{6}{15} = \frac{\square}{\square}$

5 a.

$\frac{8}{14} = \frac{\square}{\square}$

5 b.

$\frac{6}{15} = \frac{\square}{\square}$

Bu etkinlik benim için kolaydı ☺ Çünkü;

Bu etkinlik benim için zordu ☹ Çünkü;