ZENBAKIZKO-HITZEZKO
ARRAZOIBIDEA

Kalkulatu irudi hauen arteko batura eta bilatu bakoitzaren balioa:

				17	24			21
			=	=	=	=	=	=
karratua: _____		=						
zirkulua: _____	23	=						
laukizuzena: _____	24	=						
triangelua: _____	16	=						
pentagonoa: _____		=						
hexagonoa: _____		=						

BAIMENA: / AUTORIZADO POR :
© IBAIZABAL/FOTOKOPIATZEKO MATERIALA
PROYECTO i.blai PROIEKTUA