Solve the following problems.

1.

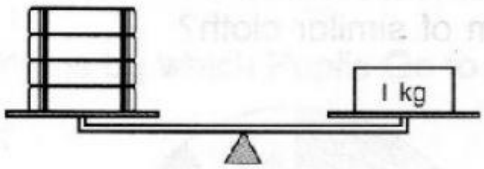

The diagram shows 4 similar dictionaries and a weight on a balanced scale. What is the total mass, in g, of 3 dictionaries?

√ _____

× _____

2.

The diagram shows the total price of 4 similar cans of drink. What is the total price of 9 similar cans of drink?

√ _____

× _____

3.

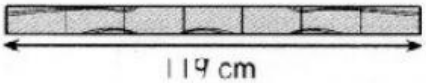

The diagram shows the total length of 7 wooden blocks. Calculate the total length, in cm, of 8 similar wooden blocks.

√ _____

× _____

4.

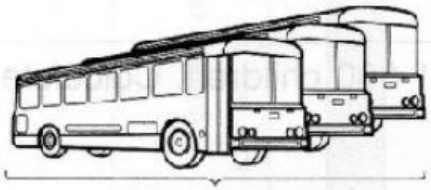

The diagram shows the number of passengers carried by 3 buses. Calculate the total passengers that can be carried by 10 similar buses.

√ _____

× _____