1) Introduceti intregii in fractie conform desenelor

1)

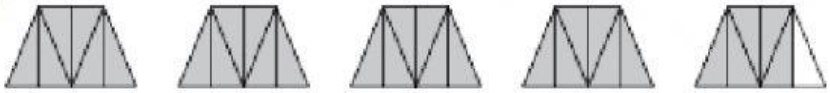

$4\frac{5}{6} = ___$

2)



$7\frac{3}{7} = ___$

3)

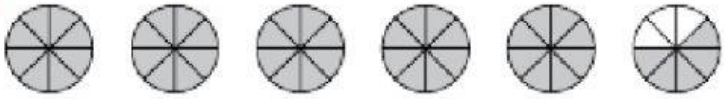

$5\frac{5}{8} = ___$

4)

$3\frac{1}{2} = ___$

5)

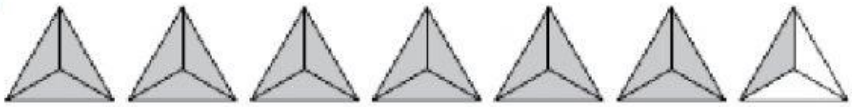

$6\frac{1}{3} = ___$

2) Rezolvati fara desene (folosind proba impartirii cu rest)

$5\frac{3}{2} = \ -\ ,\ \ 4\frac{3}{7} = \ -,\ 5\frac{3}{5} = \ -,\ 4\frac{7}{9} = \ -, 3\frac{5}{6} = \ -, 6\frac{1}{8} = \ -$