Angle Relationships Quiz

Directions: Match each angle relationship to the correct diagram, then solve for x

Word Bank:

Complementary Angles	Supplementary Angles	Vertical Angles

Problem 1:

Angle Relationship: _____

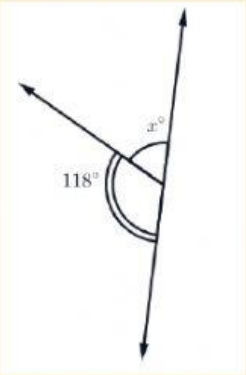

x = _____

Problem 2:

Angle Relationship: _____

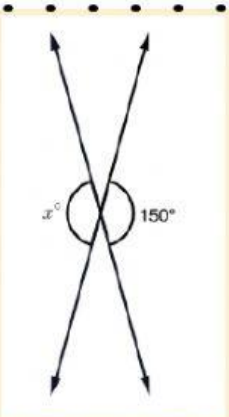

x = _____

Problem 3:

Angle Relationship: _____

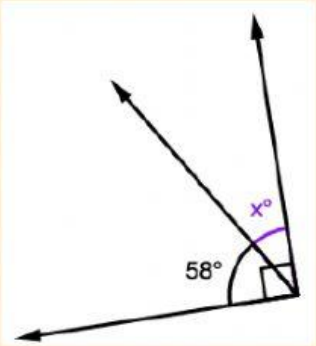

x = _____