MATEMATIK TAHUN 4

Rujukan Buku Teks : 206-208

LATIHAN 1

Hitung luas kawasan berwarna. **(Kaedah Persegi)**

Seret jawapan ke dalam ruang yang disediakan.

Hint : ***Luas segitiga ialah separuh daripada segi empat.***

6 unit persegi | **5 unit persegi** | **30 unit persegi** | **18 unit persegi**

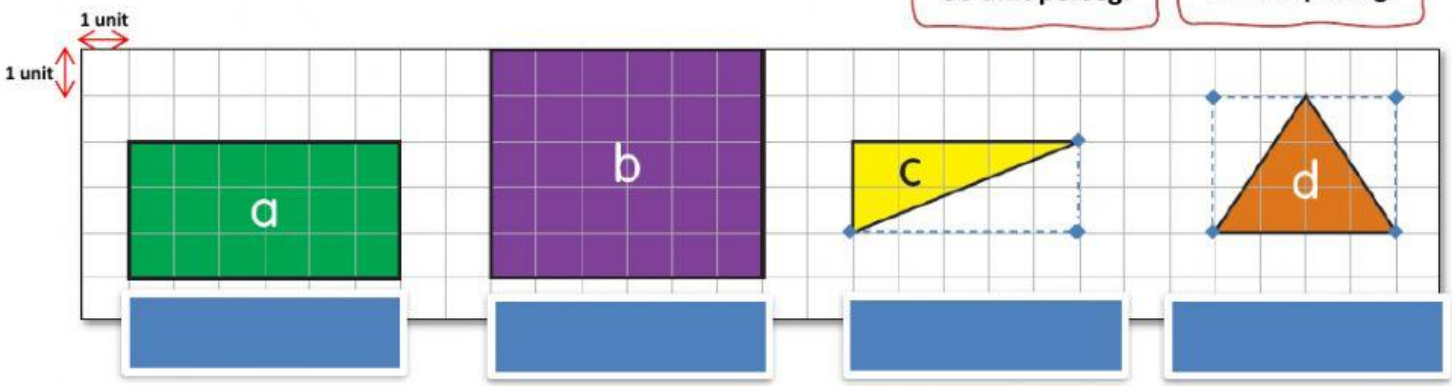

LATIHAN 2

Kira luas bentuk segi empat di bawah. **(Kaedah Formula)**

Klik pada jawapan yang betul

1.

Luas segi empat = panjang X lebar

= 5 cm X 7 cm

35 cm² | 30 cm² | 12 cm²

2.

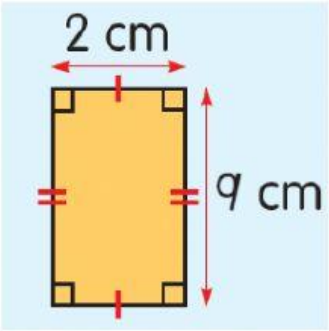

11 cm² | 18 cm² | 18 cm

3.

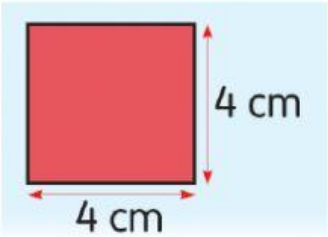

20 cm² | 8 cm² | 16 cm²

4.

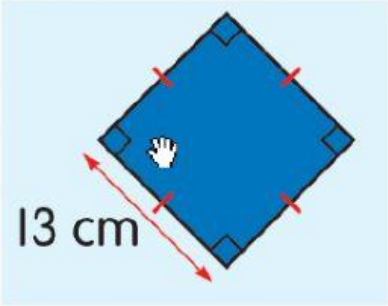

13 cm² | 26 cm² | 169 cm²