NAME : _____

CLASS : _____

TOPIC : RATIO

Recognise ratio.

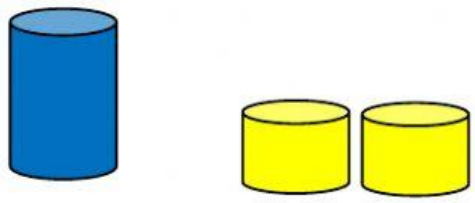

1 tin 2 tins

Ratio **blue paint** to **yellow paint**
= 1 : 2

Ratio **yellow paint** to **blue paint**
= 2 : 1

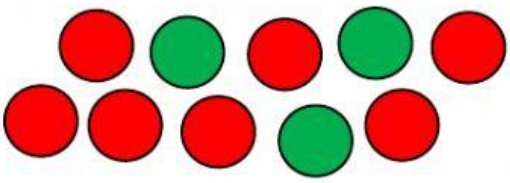

Ratio **green circle** to **red circle**
= 3 : 7

Ratio **red circle** to **green circle**
= 7 : 3

EXERCISE (Find the ratio.)

1) The table shows the number of stars awarded to neat classroom.

Class	5 Perdana	5 Waja	5 Wira	5 Satria	5 Exora	5 Kelisa
Number of stars	★★★	★★★★★★	★★	★	★★★★★	★★★★

A) State the ratio of the number of stars of 5 Waja to the number of stars of 5 Satria.

Answer :

B) State the ratio of the number of stars of 5 Kelisa to the number of stars of 5 Exora.

Answer :

C) State the ratio of the number of stars of 5 Satria to the number of stars of 5 Perdana.

Answer :

2) State the ratio of the number of purple balloons to the number of the red balloons.

A)

Answer :

B)

Answer :

C)

Answer :

3) The diagram beside shows 9 pieces of tiles. State the ratio of the number brown tiles to the number of red tiles.

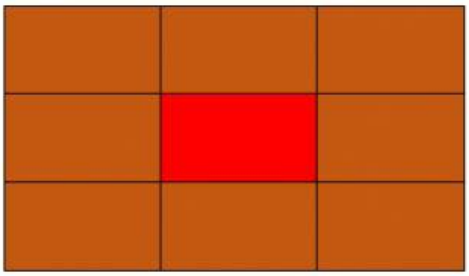

Answer :

4) The diagram shows the number of pupils in Year 2 of SK Tanjung .

Class	2 Perdana	2 Waja	2 Wira	2 Satria	2Exora	2 Kelisa
Number of pupils	23	19	20	24	25	18

A) State the ratio of the number of pupils of 2 Wira to the number of pupils of 2 Waja.

Answer :

B) State the ratio of the number of pupils of 2 Kelisa to the number of pupils of 2 Exora.

Answer :

C) State the ratio of the number of pupils of 2 Perdana to the number of pupils of 2 Satria.

Answer :

10 marks
GOOD LUCK