SAINS DAN TEKNOLOGI

Pilih dan tekan jawapan yang betul

nasrikof99

1. Which animal has feathers?
Haiwan yang manakah mempunyai bulu pelepah?

2. Look at the animal below. What is X?
Lihat haiwan di bawah. Apakah X?



3. A cockroach has
Lipas mempunyai

4. The crab, snail and tortoise are in a group. What external feature is used to group them?
Ketam, siput dan kura-kura berada dalam satu kumpulan. Apakah sifat fizikal yang digunakan untuk mengelaskan mereka?

Jawapan/answer:

5. The animals below are grouped according to their similarities.
Haiwan-haiwan yang berikut dikelaskan berdasarkan persamaannya.

Which of the animals belongs to this group?
Haiwan yang manakah tergolong dalam kumpulan ini?

Jawapan/answer:

6. All the plants below have woody stems except _____.
Semua tumbuhan bawah mempunyai batang yang berkayu kecuali _____.

Jawapan/answer:

7. Which is a non flowering plant?
Yang manakah merupakan tumbuhan yang tidak berbunga?

8. Which of the following plants produces fruit?
Tumbuhan yang manakah menghasilkan buah?

9. Which of the following magnets will repel each other?
Antara magnet yang berikut, yang manakah akan menolak di antara satu sama lain?

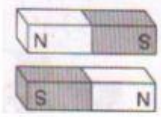


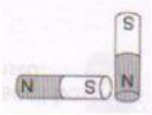

10. Which magnet is the strongest?
Magnet yang manakah paling kuat?