Thelma Gibson Primary

First Grade Computation Examination

Christmas Term 2020

Name: _____

A. Look at the number. Type the correct amount of X's to match the number. (1pt. each)

3	
5	
9	
14	
19	
10	

B. Count the pictures altogether. (1pt. each)

		

C. Find the sum. (1pt. each)

and 		make
 and 		make
and		make
and		make
and		make

D. Find the total. (1pt.)

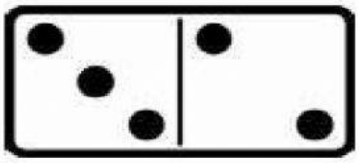

3 + 2= ☐