Name : _____		**Subject** : Geometry	
Date : ___/___/2020		**Class** : Grade 7	
Teacher : Alaa Hattab		**Duration** :	
Lesson : angles	**Department of Math**	**Score** :	

Types of angles

Drag and drop below the given degree in their respective box.

180° **140°** **60°** **90°**

	acute angle	
	Right angle	
	Obtuse angle	
	Straight angle	

Types of angles

Classify each angle as acute, obtuse or straight.

1)

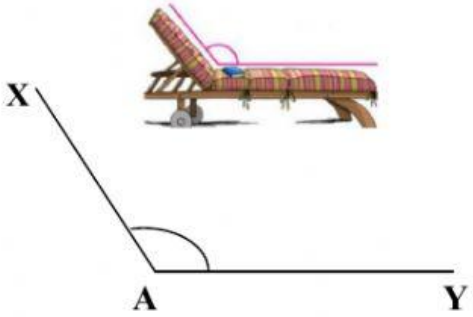

Type:

2)

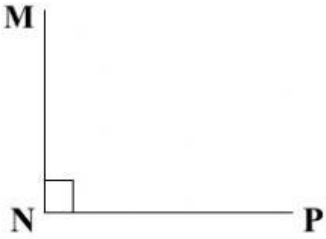

Type:

3)

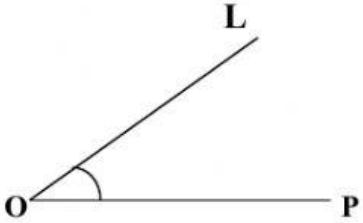

Type:

4)

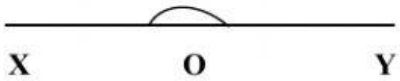

Type: