MATH APPLICATION EXAM

(Total Points = 15)

Name: _____

Read and answer **ALL** questions carefully.

1. Count the legs on the spider. Tell how many there are. [1]

   There are _____ in all.



2. Count the bats in each set. Then write the total. [1]

Answer = _____

3. What happens to ice cream if you leave it in the sun? [1]

   a. It will get hard.

   b. It will become soft.

   c. It will stay the same.

   d. It will feel smooth.

4. Pam went to the shop. She bought some buttons.



a. How many buttons are there altogether? [1]

Answer: _____

b. **Add TWO more buttons**. Now write the new number on the line. [2]

Answer: _____

5. Tom has **4** balls. He found **4** more balls. [3]
How many balls does he have in all?

_____ + _____ = _____ **balls**

6. Meg has **7** pigs. She gets **3** more pigs. [4]
What is the sum?

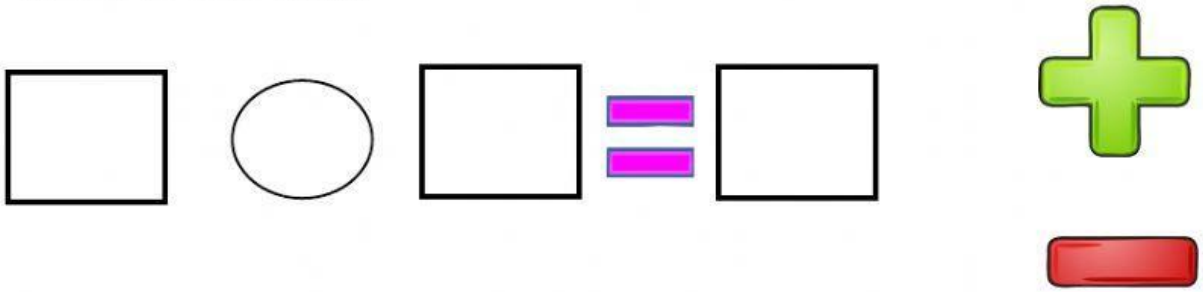

7. a. Choose the shape that describes the object. [1]

I am the shape of the sun.

I do not have any sides or corners.

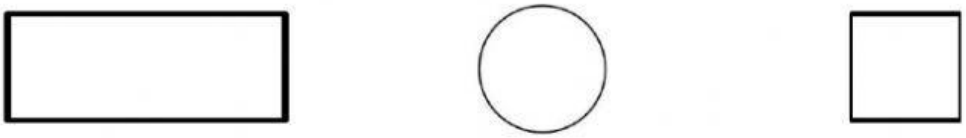

b. What shape am I? Place the name on the line. [1]

I am a _____.

triangle **rectangle** **circle**